Aufgabe 1:

Schreibe den passenden Bruch zu den Abbildungen.

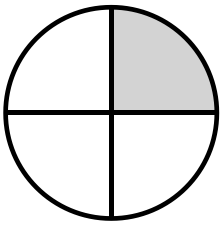

_____

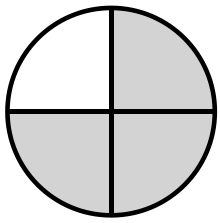

_____

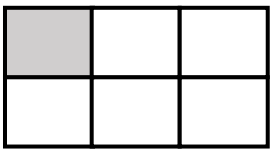

_____

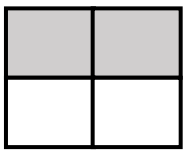

_____

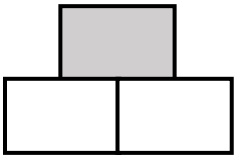

_____

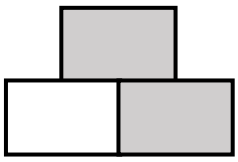

_____

Aufgabe 2:

Male den passenden Anteil aus.



$\frac{3}{4}$



$\frac{3}{8}$



$\frac{1}{3}$

CC BY SA



$\frac{1}{4}$

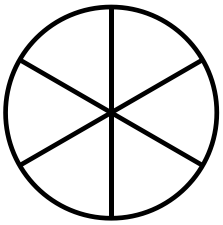

$\frac{2}{6}$



$\frac{1}{2}$

Aufgabe 3:

Wie viel Pizza ist noch da?

_____

_____

_____

_____

CC BY SA